All rights reserved. No part of this publication may be reproduced, distributed, or transmitted in any form or by any means, electronic, mechanical, photocopying, recording or otherwise, or stored in any retrieval system of any nature without the permission of cracku.in, application for which shall be made to support@cracku.in

Downloaded from cracku.in

SSC CHSL 5th August 2021 Shift-3

English Language

1. **Select the INCORRECTLY spelt word.**

A Fragrance

B Interfere

C Temparary

D Accustomed

Answer: C

2. **Select the most appropriate meaning of the idiomatic expression given.**
   To poke one's nose into

A To clean one's nose with a twig

B To bury oneself in another matter

C To insert something in another's nose

D To take interest in others' affairs

Answer: D

3. **Select the most appropriate option to substitute the underlined segment in the given sentence. If there is no need to substitute it, select 'No substitution'.**
   Large glasses magnified his eyes <u>so that to gave</u> him the appearance of a wise owl.

A as though to gave

B so that it gives

C No substitution

D so as to give

Answer: D

4. **In the given sentence, identify the segment which contains a grammatical error.**
   Despite of being a close friend he did not help me in any way.

A a close friend

B in any way

C he did not help me

D Despite of being

Answer: D

SSC CHSL Free Mock Test

Downloaded from cracku.in

5. **Select the most appropriate ANTONYM of the given word.**
Restrictive

A Thrifty

B Broad

C Liberal

D Closed

Answer: C

6. **Select the option that can be used as a one-word substitute for the given group of words.**
Relating to soldiers or war

A Martial

B Official

C Political

D Marital

Answer: A

7. **Select the most appropriate antonym of the given word.**
NEGLECT

A fail

B care

C omit

D trust

Answer: B

SSC CHSL Prevoius Papers (DOWNLOAD PDF)

8. **Select the option that expresses the given sentence in active or passive voice.**
Wi-Fi hotspots will be installed by the government in remote areas by 2022.

A Wi-Fi hotspots will install in remote areas by 2022 by the government.

B Remote areas will install Wi-Fi hotspots by the government by 2022.

C The government will install remote areas and hotspots by 2022.

D The government will install Wi-Fi hotspots in remote areas by 2022.

Answer: D

9. **The following sentence has been split into four segments. Identify the segment that contains a grammatical error.**
The police arrested / two young men, but / neither of them were / responsible for the robbery.

A for the robbery

Downloaded from cracku.in

B two young men, but

C The police arrested

D neither of them were

Answer: D

10. **Fill in the blank with most appropriate word.**
The old building was _____ by the authorities.

A pulled through

B pulled down

C pulled up

D pulled off

Answer: B

SSC CGL Previous Papers (DOWNLOAD PDF)

11. **Select the most appropriate synonym of the given word.**
Herald

A Halt

B Announce

C Suppress

D Succeed

Answer: B

12. **Select the most appropriate option to substitute the underlined segment in the given sentence. If there is no need to substitute it, select 'No substitution required'.**
I want to buy this book. Please give me <u>any money.</u>

A some money

B less money

C No substitution required

D little money

Answer: A

13. **Select the most appropriate one-word substitution for the given words.**
one who pretends to be what he is not

A stoic

B fanatic

C hypocrite

D optimist

Downloaded from cracku.in

Answer: C

SSC CGL Free Mock Test (Latest Pattern)

14. **Select the misspelt word.**

A vicious

B trecherous

C lustrous

D pompous

Answer: B

15. **Select the most appropriate word to fill in the blank.**
Despite their _____, impersonal rules that apply to all are essential in large systems.

A support

B advantages

C benefits

D limitations

Answer: D

16. **Select the correct indirect form of the given sentence.**
The watchman said, "I did not see anyone last night."

A The watchman said that he had not seen anyone the previous night.

B The watchman said that he did not see anyone last night.

C The watchman said that he did not saw anyone the previous night.

D The watchman said that I had not seen anyone last night.

Answer: A

SSC CHSL Important Questions and Answers (Download PDF)

17. **Select the most appropriate meaning of the underlined idiom in the given sentence.**
The friends quarrelled some time ago but now they are trying <u>to make up</u> with each other.

A to part forever

B to blame each other

C to compete with one another

D to settle their differences

Answer: D

Downloaded from cracku.in

18. **Given below are four sentences in jumbled order. Select the option that gives their correct order.**
A. The other was a ruffled, glum-faced man, heavily built and roughly dressed.
B. One man had a handsome presence with a bold and frank look.
C. But the most striking thing was that they were handcuffed together.
D. The two men who boarded the train from Denver were an odd pair.

A DCAB

B BADC

C ADCB

D DBAC

Answer: D

19. **Sentences of a paragraph are given below in jumbled order. Arrange the sentences in the right order to form a meaningful and coherent paragraph.**
A. Earlier, they had to look through hundreds of mugshots in large books and they could make a positive identification only in 5% of the cases.
B. This saves a lot of time and effort and also leads to more positive identifications.
C. Now computers make this easier for witnesses by projecting only pictures that match the descriptions closely.
D. After a crime, witnesses often give the police a description and thus help to identify the criminal.

A DACB

B CBAD

C BACD

D ACBD

Answer: A

SSC CHSL Study Material

20. **Select the most appropriate synonym of the given word.**
ADEPT

A clumsy

B rough

C lazy

D skilled

Answer: D

Instructions [21 - 25]

In the following passage, some words have been deleted. Select the most appropriate option to fill in each blank.

Comprehension:
We must understand that people can process very little information presented orally. So, it is (1) _____, particularly for a teacher, to realise that the students have sometimes listened to three or four teachers (2) _____ you. So, the teacher must have props like notes, handouts and slides that will make the learning material (3) _____ alive for the students and stay that way with them. A visual aid, a little movement or colour will get the students' attention. Another important thing to (4) _____ is that long, complicated sentences spoken fast are simply too difficult for students to understand. It is, therefore, (5) _____ to use short sentences that make sense to them instantly.

Downloaded from cracku.in

21. **Select the most appropriate option to fill in blank number 1.**

A urgent

B unnecessary

C important

D immaterial

Answer: C

22. **Select the most appropriate option to fill in blank number 2.**

A after

B beside

C behind

D before

Answer: D

SSC CHSL Free App

23. **Select the most appropriate option to fill in blank number 3.**

A be

B go

C come

D stay

Answer: C

24. **Select the most appropriate option to fill in blank number 4.**

A guess

B determine

C realise

D decide

Answer: C

25. **Select the most appropriate option to fill in blank number 5.**

A advisable

B mandatory

C compulsory

D critical

Downloaded from cracku.in

Answer: A

Daily Free SSC Practice Set

General Intelligence

26. **Read the given statements and conclusions carefully. Assuming that the information given in the statements is true, even if it appears to be at variance with commonly known facts,**
decide which of the given conclusions logically follow(s) from the statements.
Statements:
Some drivers are artists.
All fathers are artists.
No father is a doctor.
Conclusions:
I. No doctor is an artist.
II. No driver is a doctor.
III. Some artists are fathers.

A Both conclusions I and III follow

B Only conclusion II follows

C Only conclusion III follows

D Both conclusions I and II follow

Answer: C

Free SSC Study Material (18,000 Solved Questions)

27. **Select the figure that will replace the question mark (?) in the following figure series.**

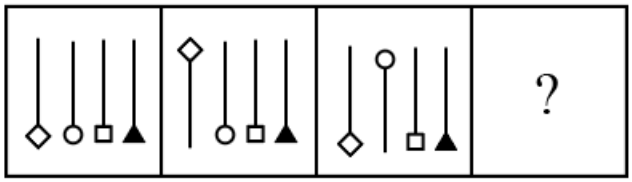

A
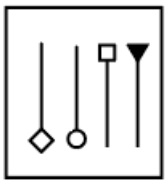

B
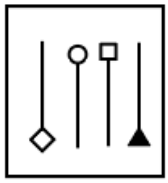

C
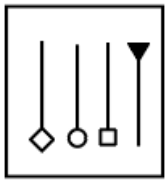

Downloaded from cracku.in

D 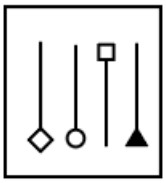

Answer: D

28. **In a code language, if LOCK is written as 1212311 and KEY is written as 112225, then how will DEAR be written in the same language?**

A 4232609

B 4222618

C 4052619

D 4220218

Answer: B

29. **Select the number from among the given options that can replace the question mark (?) in the following series.**
52, ?, 113, 162, 226, 307

A 70

B 77

C 89

D 83

Answer: B

1500+ Very Important Free SSC Solved Questions

30. **Three of the following four letter-cluster pairs are alike in a certain way and one is different. Select the odd one.**

A FRY : HTB

B TAP : VDT

C DRY : FUC

D RAT : TDX

Answer: A

31. **Select the option that is related to the third word in the same way as the second word is related to the first word.**
Kick : Football : : Backstroke : ?

A Swimming

B Polo

C Weight lifting

D Cricket

Answer: A

Downloaded from cracku.in

32. **Select the option in which the given figure is embedded (rotation is NOT allowed).**

A 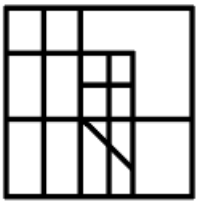

B 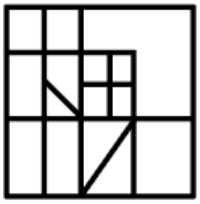

C 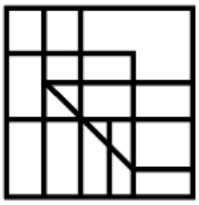

D 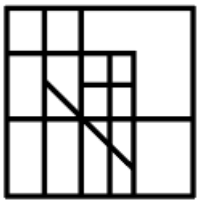

Answer: D

SSC Exam Update Videos & Free Study Material (YouTube Channel)

33. **Select the correct mirror image of the given combination when the mirror is placed at MN as shown.**

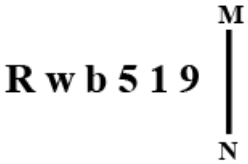

A 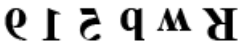

B 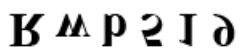

C

D

Answer: C

Downloaded from cracku.in

34. **In a group of 72 workers, each worker participates in one or more of three activities, i.e. Quiz, Mono-acting and Mimicry. 11 workers participate in Quiz only, 15 participate in Mono acting only and 14 participate in Mimicry only. If 5 workers participate in all three activities, then how many workers participate in any two activities?**

A 25

B 37

C 27

D 15

Answer: C

35. **Select the option in which the numbers are related in the same way as are the numbers of the following set.**
(21, 13, 17)

A (11, 21, 140)

B (25, 35, 38)

C (22, 57, 81)

D (32, 46, 39)

Answer: D

Latest Job Updates on Telegram - Join here

36. **Select the option in which the numbers in the set share the same relationship as the numbers in the given set.**
(25, 19, 36)

A (27, 11, 38)

B (20, 14, 66)

C (24, 22, 49)

D (22, 17, 25)

Answer: D

37. **Two different positions of the same dice are shown, the six faces of which are numbered from 1 to 6. Select the number that will be on the face opposite to the one having '4'.**

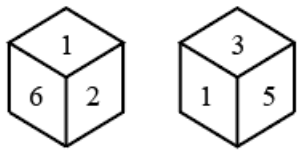

A 1

B 5

C 3

D 2

Answer: A

Downloaded from cracku.in

38. **In a certain code language, 'MODERATE' is written as 'OQEFTBVF' and 'LIFE' is written as 'NJGF'. How will 'CLEAR' be written in that language?**

A ENFBT

B DOFCT

C DNFBT

D DNGBU

Answer: C

Join SSC Daily Quiz Telegram Group

39. **Select the correct combination of mathematical signs that can sequentially replace the * signs and balance the given equation.**
100 * 25 * 35 * 15 * 5 * 190

A $-, +, \div, \times, =$

B $\times, -, +, \div, =$

C $-, +, \times, \div, =$

D $+, -, \div, \times, =$

Answer: C

40. **How many triangles are there in the figure given below?**

A 10

B 9

C 8

D 11

Answer: A

41. **Select the option that is related to the third term in the same way as the second term is related to the first term.**
TANGLE : XERKPI : : FIGHTS : ?

A JMKLXW

B JMKMXX

C JNOLXW

D KMKLYW

Answer: A

Downloaded from cracku.in

42. **Select the combination of letters that when sequentially placed in the blanks of the given series will complete the series.**
H _ Z _ H O Z C H O _ D _ O _ E H _ Z F

A O B Z H Z O

B O C Z H Z H

C O B H O Z O

D H B Z H H O

Answer: A

43. **Select the word-pair in which the two words are related in the same way as are the two words in the following word-pair.**
Courage : Bravery

A Aggressive : Fragile

B Patience : Violent

C Afraid : Lazy

D Systematic : Orderly

Answer: D

44. **Select the option that is related to the fourth number in the same way as the first number is related to the second number and the fifth number is related to the sixth number.**
11 : 242 : : ? : 162 : : 14 : 392

A 9

B 10

C 8

D 12

Answer: A

SSC CHSL Free Mock Test

45. **In the Venn diagram given below. if 'Hexagon' represents 'Fanners', 'Triangle' represents Villagers' and 'Square' represents 'Beneficiaries', then how many Farmers are there who are Villagers and Beneficiaries also?**

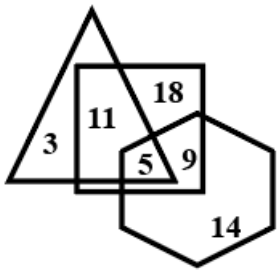

A 9

B 18

Downloaded from cracku.in

C 11

D 5

Answer: D

46. **The sequence of folding a piece of paper and the manner in which the folded paper has been cm is shown in the following figures. How would this paper look when unfolded?**

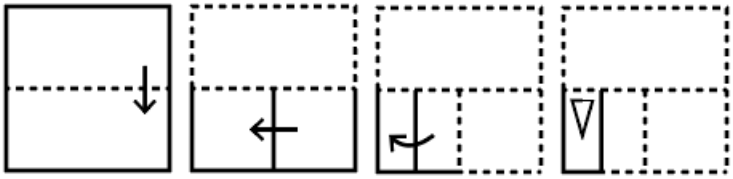

A

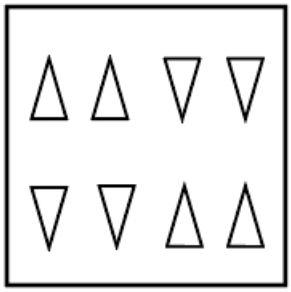

B

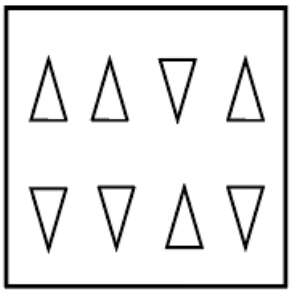

C

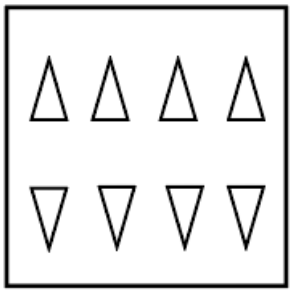

D

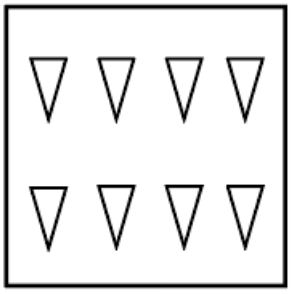

Answer: C

47. **Four words have been given, out of which three are alike in some manner and one is different. Select the word that is different.**

A Gastroenterologist

B Psychiatrist

Downloaded from cracku.in

C Ophthalmologist

D Cardiologist

Answer: B

SSC CHSL Prevoius Papers (DOWNLOAD PDF)

48. **A family consists of six members. Surendar is the son of Revant. Pranavi is the wife of Revant. Yugal is the brother of Revant. Kundana is the daughter of Pranavi. Janardan is the brother of Pranavi. How many children does Pranavi have?**

A 4

B 3

C 2

D 1

Answer: C

49. **Four number-pairs have been given, out of which three are alike in some manner and one is different. Select the one that is different.**

A 9 : 734

B 7 : 348

C 5 : 130

D 8 : 516

Answer: D

50. **Select the option that represents the correct order of the given words as they would appear in an English dictionary.**
    1. Primary
    2. Pristine
    3. Predator
    4. Precaution
    5. Preserve

A 4, 5, 3, 1, 2

B 3, 4, 5, 1, 2

C 4, 3, 5, 1, 2

D 4, 3, 5, 2, 1

Answer: C

SSC CGL Previous Papers (DOWNLOAD PDF)

Quantitative Aptitude

51. **Sachin alone can complete a piece of work forts ₹8,500 in $8\frac{1}{2}$ days. But with the help of ViShnu, the work is completed in 6 days. The share to be paid to Vishnu is:**

Downloaded from cracku.in

A ₹3,200

B ₹2,500

C ₹2,400

D ₹2,000

Answer: B

SSC CGL Free Mock Test (Latest Pattern)

52. **If $x - y = 4$ and $x^3 - y^3 = 316$, then the value of $x^4 + y^4$ is:**

A 2248

B 2482

C 2428

D 2284

Answer: B

53. **An article was sold at a loss of 24%. If it were sold for ₹1,596 more, then there would have been a gain of 18%. The cost price of the article is:**

A ₹3,400

B ₹3,600

C ₹3,800

D ₹4,200

Answer: C

54. **If $a : b = 3 : 5, b : c = 7 : 8$ and $c : d = 2 : 3$, then 2a : 3b is equal to:**

A 1 : 2

B 7 : 30

C 7 : 15

D 7 : 20

Answer: B

SSC CHSL Important Questions and Answers (Download PDF)

Downloaded from cracku.in

55. Study the following graph and answer the question that follows.
Number of students that appeared and qualified. from various colleges, at a scholarship examination.

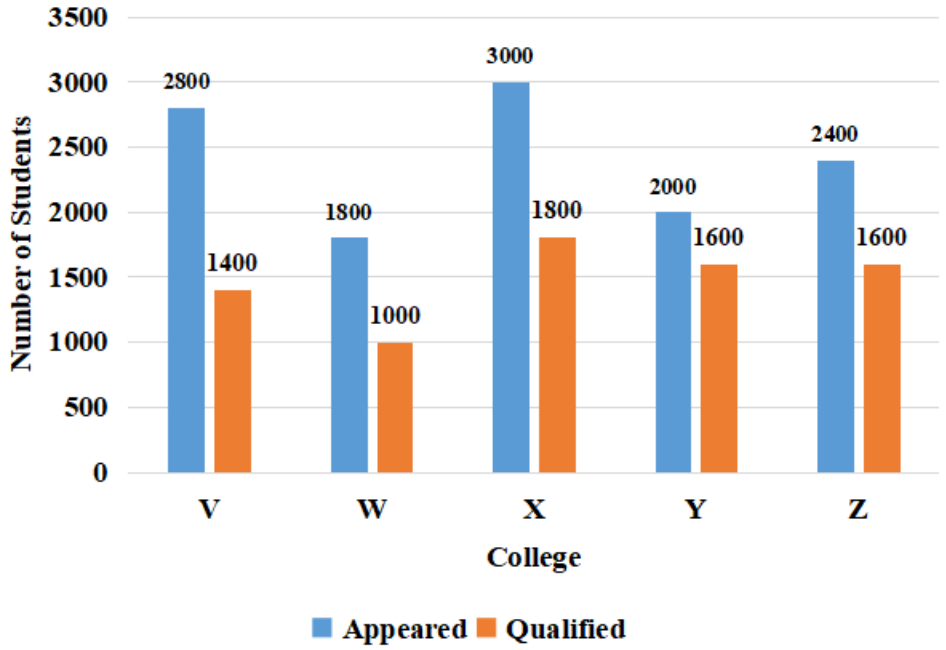

What is the difference between the average number of students that appeared for the scholarship examination from all the given colleges, and the average number of students that qualified from all the colleges together?

A 920

B 940

C 930

D 910

Answer: A

56. The number of students enrolled in different streams at Senior Secondary level in five schools is shown in the given bar graph. The number of students enrolled in the Humanities stream in schools A, and D is what percentage of the number of students enrolled in the Vocational stream in schools C, D and E?

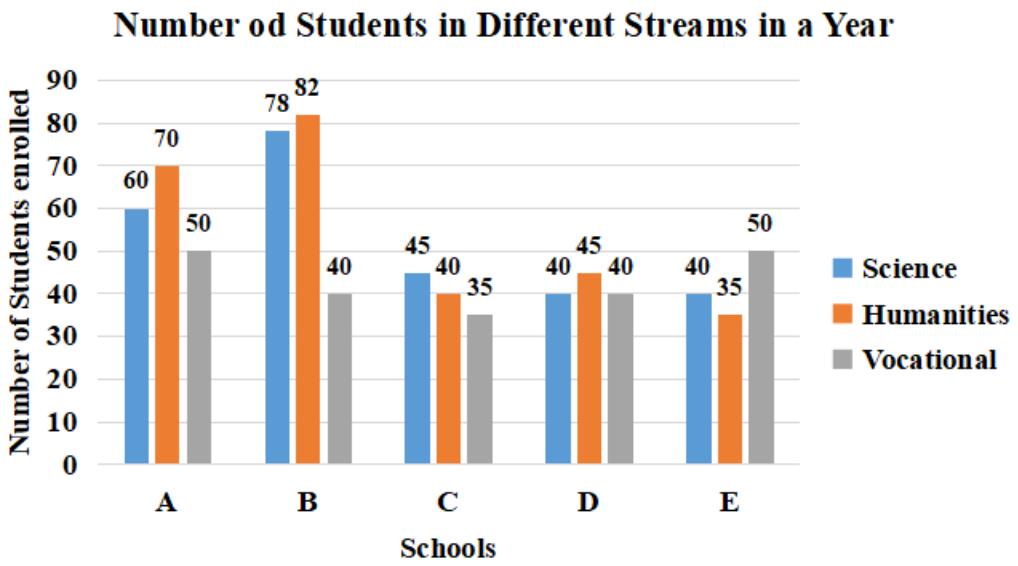

A 75

B 80.64

Downloaded from cracku.in

C 115

D 124

Answer: D

57. **The in-radius and circumrodius of a right-a ngled rria ngle is 3 cm and 12 .5 cm., respectively. The area of the rriangle is:**

A 64 cm^2

B 48 cm^2

C 88 cm^2

D 84 cm^2

Answer: D

SSC CHSL Study Material

58. **If** $a + b = 24$ **and** $a^2 + b^2 = 306$**, where** $a > b$**, then the value of** $4a - 5b$ **is:**

A 18

B 20

C 12

D 15

Answer: D

59. **If the number 87m6203m is divisible by 6, then find the sum of all possible values of 'm'.**

A 10

B 20

C 16

D 15

Answer: A

60. **What is the coefficient of** y^2 **in the expansion of** $(\sqrt{2}y^2 - 5\sqrt{3})^3$**?**

A $-225\sqrt{2}$

B $-30\sqrt{3}$

C $225\sqrt{2}$

D $30\sqrt{3}$

Answer: C

SSC CHSL Free App

Downloaded from cracku.in

61. Study the given bar graph and answer thee question that follows.
The bar graph shows the production of table fans in a factory during one week.

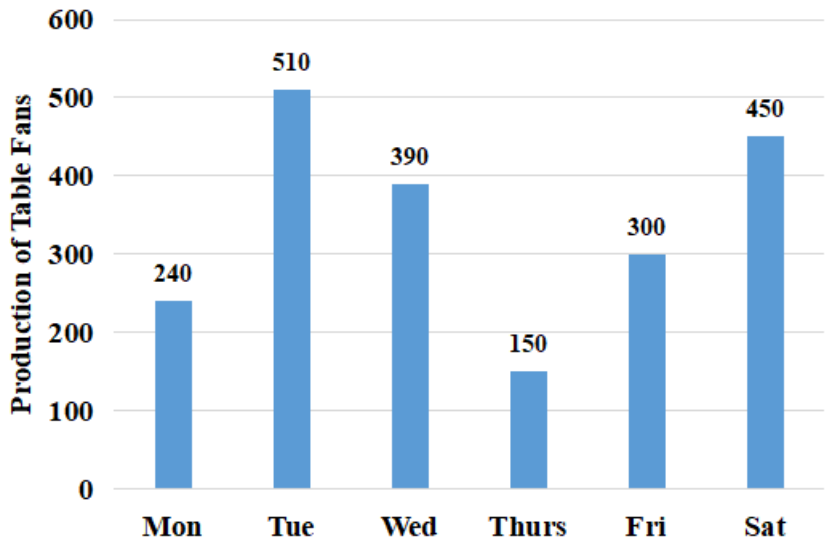

The average production of table fans on Friday and Saturday exceeds the average production of table fans during the week by:

A 45

B 30

C 35

D 40

Answer: C

62. In a triangle ABC, if BD and CD bisect $\angle B$ and $\angle C$, respectively, and $\angle A = 100^\circ$, then find $\angle BDC$.

A 130°

B 100°

C 110°

D 140°

Answer: D

63. Two circles of radii 4 cm and 3 cm, respectively, touch each other externally. What is the distance (in cm.) berween their centres?

A 5

B 16

C 7

D 9

Answer: C

Daily Free SSC Practice Set

64. A number P is 20% more ihan a number Q but 10% less than a number R. What percentage is number Q of number R?

Downloaded from cracku.in

A 80

B 85

C 75

D 90

Answer: C

65. **If $\cos\theta = \frac{7}{3\sqrt{6}}$ and θ is an acute angle, then the value of $27\sin^2\theta - \frac{3}{2}$ is:**

A 12

B 15

C 1

D 9

Answer: C

66. **During his morning walk. Atul walks for 45 minutes at a speed of 8 km/h and takes 15 rounds of a park. Shekhar takes 10 rounds of the same park in 40 minutes. What is the speed of Shekhar in km/h?**

A 7.2

B 6

C 6.75

D 7.5

Answer: B

Free SSC Study Material (18,000 Solved Questions)

67. **For $A = 30^\circ$, find the value of:** $\frac{-3\sin^2 2A + 2\sec^2 A - \tan\frac{3A}{2}}{\frac{1}{3}\sin 3A}$

A $-\frac{7}{4}$

B $-\frac{7}{36}$

C $\frac{57}{4}$

D $-\frac{11}{4}$

Answer: A

68. **Find the value of θ, if $\sec^2\theta + (1-\sqrt{3})\tan\theta - (1+\sqrt{3}) = 0$, where θ is an acute angle.**

A 60°

B 30°

C 45°

Downloaded from cracku.in

D 15°

Answer: A

69. **How many spherical bullets. each bullet being 7 cm in diameter, can be made out of a cube of lead whose edge measmes 77 cm?(Take $\pi = \frac{22}{7}$)**

A 1452

B 4521

C 2451

D 2541

Answer: D

1500+ Very Important Free SSC Solved Questions

70. **The distance between two equal parallel chords of a circle is 10 cm. If the chords are 24 cm long, then what is the length of the radius?**

A $2\sqrt{61}$ cm

B 17 cm

C 26 cm

D 13 cm

Answer: D

71. **The numbers 2, 3, 4 and 5 occur (2 + 5k), (5k - 7), (2k - 3) and (k + 2) times, respectively. The average of rhe numbers is 2.85. Later on, the number 2 was replaced by 6 in all the places. What is the average of the new numbers?**

A 2.4

B 5.25

C 3.85

D 4.75

Answer: B

72. **Krishan invested a sum of ₹25,000 in two parts. He earned 11% p.a. simple interest on part 1 and 10% p.a. compound interest compounded annually on part 2. If the total interest received by him after 2 years is ₹5,370, then fmd the sum invested on simple interest.**

A ₹11,000

B ₹12,000

C ₹12,500

D ₹13,000

Answer: B

Downloaded from cracku.in

73. **The value of** $18\frac{2}{11} \div \left[\frac{7}{33} + \left\{\frac{29}{6} - \frac{3}{11} \times \left(5\frac{1}{6} - 3\frac{1}{3}\right)\right\}\right]$ **is:**

A 4

B 5

C 2

D 8

Answer: A

74. **An article is listed at ₹ 5,000 and two successive discounts of 12% and 12% are given on it. How much will the seller gain or lose if he gives a single discoum of 24%?**

A Loss ₹72

B Loss ₹64

C Profit ₹64

D Profit ₹72

Answer: A

75. **The given pie charts show the distribution of students of graduate and postgraduate levels in five different institutes, P, Q, R, S and T, in a town. Study the pie charts and answer the question that follows.**
(i) Total number of students of graduate level in five different institutes = 12400

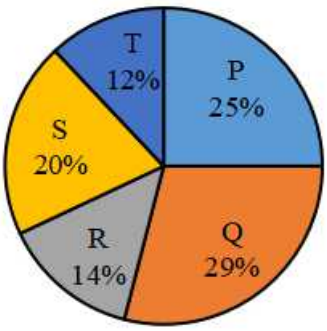

Fig.(i)

(ii) Total number of students of postgraduate level in five different institutes = 8000

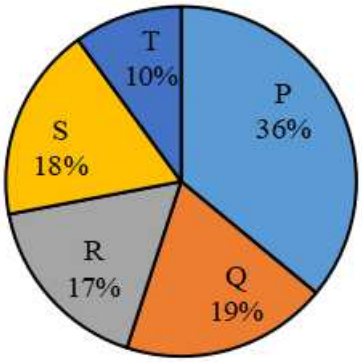

Fig.(ii)

The total number of graduate and post graduate level students in institute Q is:

A 5216

Downloaded from cracku.in

B 5126

C 5116

D 4116

Answer: C

Latest Job Updates on Telegram - Join here

General Awareness

76. **How many Olympic Medals did India win in the sport of wrestling, as of January 2021?**

A Two

B Four

C Three

D Five

Answer: D

Join SSC Daily Quiz Telegram Group

77. **Which of the following is the world's third-highest mountain that connects the borders of India and Nepal?**

A Nanga Parbat

B Kanchenjunga

C K2

D Broad Peak

Answer: B

78. **In which state was the foundation stone for a water supply project laid down by Prime Minister Narendra Modi in July 2020?**

A Manipur

B Uttar Pradesh

C Telangana

D Punjab

Answer: A

79. **What is the minimum age to be an eligible voter for Lok Sabha elections?**

A 17 years

B 15 years

C 18 years

Downloaded from cracku.in

D 16 years

Answer: C

80. **Which type of storage device is a hard disk?**

A Secondary

B Tertiary

C Off-line

D Primary

Answer: A

81. **What is the use of the functional key F7 in Microsoft Word 2010?**

A It is used to open the Help window.

B It is used to run spell check and grammar check.

C It is used for renaming files and folders.

D It is used as a search key.

Answer: B

82. **The cause of Siderosis is excessive deposition of _____ in the body tissue.**

A iron

B aluminium

C coal

D zinc

Answer: A

SSC CHSL Free Mock Test

83. **How many storeys does Qutab Minar have in Delhi?**

A Five

B Eight

C Seven

D Six

Answer: A

84. **Who among the following was conferred with the 'Best Actor' award at the Dadasaheb Phalke International Film Festival in February 2020?**

A Hrithik Roshan

Downloaded from cracku.in

B Amir Khan

C Ranveer Singh

D Ranbir Kapoor

Answer: A

85. **By which amendment of the Constitution of India were the terms 'socialist' and 'secular' added in the preamble?**

A Constitution (Forty-First Amendment) Act, 1976

B Constitution (Forty-Third Amendment) Act, 1977

C Constitution (Forty-Fourth Amendment) Act, 1978

D Constitution (Forty-Second Amendment) Act, 1976

Answer: D

SSC CHSL Prevoius Papers (DOWNLOAD PDF)

86. **Who won the 10 m air rifle event at the fifth edition of the International Online Shooting Championship in October 2020?**

A Rahi Sarnobat

B Manu Bhaker

C Divyansh Singh Panwar

D Visnu Shivaraj Pandian

Answer: D

87. **Lohit river is a tributary of:**

A Ghaghara

B Yamuna

C Chambal

D Brahmaputra

Answer: D

88. **Who among the following is the first Indian to be awarded with UN Military Gender Advocate Award in May 2020?**

A Shivangi Singh

B Suman Gawani

C Jyoti Sharma

D Rani Rampal

Answer: B

Downloaded from cracku.in

89. **Which of the following statements about bromine is correct?**

A It is a metal.

B It is a gas at room temperature.

C It is a solid at room temperature.

D It is a liquid at room temperature.

Answer: D

90. **In September 2020, who was appointed as the Chairman of National School of Drama?**

A Paresh Rawal

B Nawazuddin Siddiqui

C Anupam Kher

D Waman Kendre

Answer: A

91. **In the central budget 2020-21 the eligibility limit for NBFCs for debt recovery under the SARFAESI Act was proposed to be reduced to an asset size of:**

A ₹200 crores

B ₹300 crores

C ₹100 crores

D ₹400 crores

Answer: C

SSC CGL Free Mock Test (Latest Pattern)

92. **With which of the following sports is Murugappa Gold Cup associated?**

A Table tennis

B Hockey

C Football

D Cricket

Answer: B

93. **In which of the following states is Sambhar Salt Lake situated?**

A Rajasthan

B Gujarat

Downloaded from cracku.in

C Andhra Pradesh

D Punjab

Answer: A

94. **Which of the following statements is correct?**

A In 1774, the Asiatic Society was founded by Sir Williams Jones.

B In 1775, the Siraj ud-Daulah was defeated in the Battle of Plassey.

C In 1776, the first railway service began from Bombay to Thane.

D In 1793, the Cornwallis code was enacted.

Answer: D

SSC CHSL Important Questions and Answers (Download PDF)

95. **Where is Kandariya Mahadev Temple situated?**

A Khajuraho

B Modhera

C Deogarh

D Aurangabad

Answer: A

96. **Which of the following Indian cities hosted the International Summit on Women in STEM (Science, Technology, Engineering and Mathematics) in January 2020?**

A Hyderabad

B Pune

C New Delhi

D Lucknow

Answer: C

97. **In which of the following states is the Bhadra Wildlife Sanctuary located?**

A West Bengal

B Karnataka

C Bihar

D Gujarat

Answer: B

SSC CHSL Study Material

Downloaded from cracku.in

98. **Cuscuta is an example of:**

A autotroph

B saprotroph

C host

D parasite

Answer: D

99. **Who was the founder of the Mamluk dynasty in India?**

A Qutb al-Din Aibak

B Bakhtiyar Khilji

C Razia Sultan

D Iltutmish

Answer: A

100. **In which year was the Marine Products Export Development Authority (MPEDA) established in India?**

A 1948

B 1974

C 1947

D 1972

Answer: D

SSC CHSL Free App

SSC CHSL Free Mock Test

SSC CHSL Prevoius Papers (DOWNLOAD PDF)

SSC CGL Previous Papers (DOWNLOAD PDF)

SSC CGL Free Mock Test (Latest Pattern)

SSC CHSL Important Questions and Answers (Download PDF)

SSC CHSL Study Material

Downloaded from cracku.in

SSC CHSL Free App

Daily Free SSC Practice Set

Free SSC Study Material (18,000 Solved Questions)

1500+ Very Important Free SSC Solved Questions

SSC Exam Update Videos & Free Study Material (YouTube Channel)

Latest Job Updates on Telegram - Join here

Join SSC Daily Quiz Telegram Group

Downloaded from cracku.in